Ujian keterusan telah dilakukan kepada Fius Katrij. Berpandukan gambar rajah dalam rajah 1, tuliskan keadaan elemen pemanas tersebut. Samaada BAIK, ROSAK TERPINTAS atau ROSAK TERBUKA

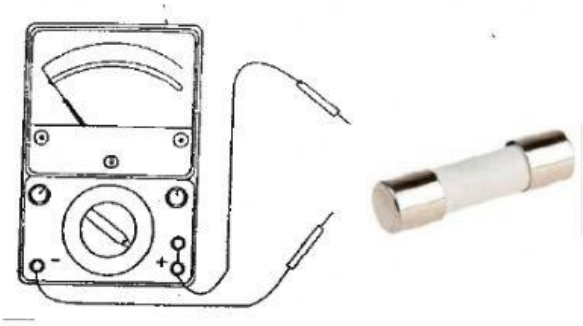

Kedudukan Jarum Meter	Keadaan Elemen Pemanas
1. Jarum bergerak naik dan ada bacaan 	....
2. Jarum naik pada bacaan kosong	....
3. Bacaan jarum infiniti 	....

Rajah 1

LIVEWORKSHEETS