SCIENCE YEAR 4 (UNIT 3 : VERTEBRATES & INVERTEBRATES)

INSTRUCTION : FILL IN THE BLANK WITH THE CORRECT ANSWER

4. The table below shows the classification of vertebrates animal. LS3.2.3

PL3 PL4 (a) Complete the table with the correct characteristics.

Group of animals	Characteristics
 Group P	i. _____ blooded ii. Breathe through their _____ iii. Breed by _____ iv. Body covered with _____
 Group Q	i. _____ blooded ii. Breathe through the _____ iii. Breed by _____ iv. Body covered with _____ and have _____
 Group R	i. _____ blooded ii. Breathe through the _____ iii. Breed by _____ iv. Body covered with _____ and _____
 Group S	i. _____ blooded ii. Breathe through their _____ iii. Breed by _____ iv. Body covered with _____
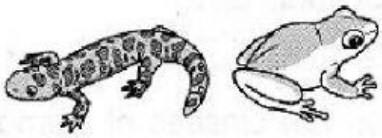 Group T	i. _____ blooded ii. Breathe through their _____ and _____ iii. Breed by _____ iv. Live in _____ and on _____

LIVEWORKSHEETS

SCIENCE YEAR 4 (UNIT 3 : VERTEBRATES & INVERTEBRATES)



Group P



Group Q



Group S



Group R

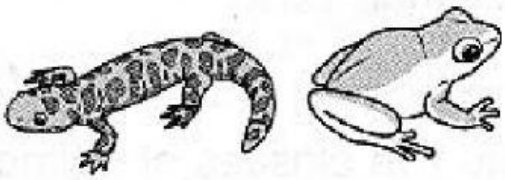

Group T

(b) Name the following groups.

Group P: _____ Group S: _____

Group Q: _____ Group T: _____

Group R: _____

LIVEWORKSHEETS