PONAVLJANJE ZA ISPIT IZ TEORIJE

1. Iznad crtovlja u prazno polje upiši notu koja čini traženi interval, a na crtu kraticom napiši obrat intervala (samo naziv, npr. v3 ili v 3).



2. Odredi vrstu tetrakorda:



3. a) Odredi u kojem duru pronalazimo ove D7:

3. b) Izgradi D7 na zadanim tonovima!
(Napiši samo tonove koji nedostaju razmaknute crticom, npr. a-c-es.)



LIVEWORKSHEETS

4. a) Izgradi tražene trozvuke!
(Napiši samo tonove koji nedostaju razmaknute crticom, npr. c-e)

4. b) Iznad crtovlja u prazno polje napiši tonove koji nedostaju (kao u zadatku 4. a)), a zatim ispod odredi mnogostranost!



5. Koji predznaci imaju ove tonalitete?



LIVEWORKSHEETS