Luas Persegi dan Persegi Panjang

Nama: _____ **Kelas:** _____

Tentukan luas dari persegi dan persegi panjang berikut!

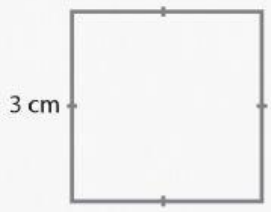

Luas: _____ cm^2

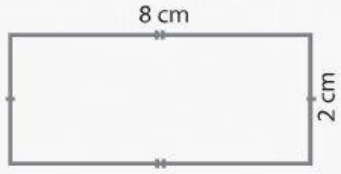

Luas: _____ cm^2

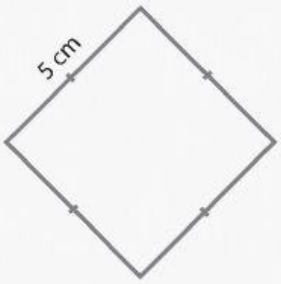

Luas: _____ cm^2

Luas: _____ cm^2

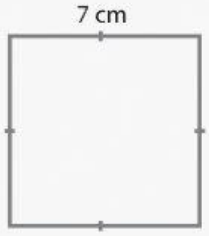

Luas: _____ cm^2

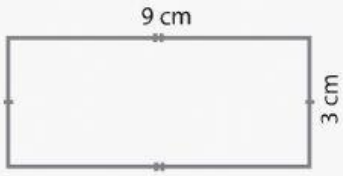

Luas: _____ cm^2

Luas: _____ cm^2

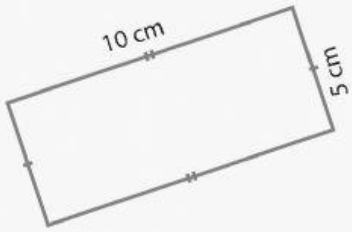

Luas: _____ cm^2

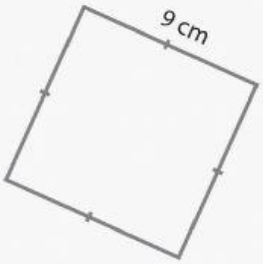

Luas: _____ cm^2

LIVEWORKSHEETS