Fractions and Mixed Numbers

Choose the best term from the list.

equivalent fraction **mixed number**
fraction **simplest form**

1. A _____ is made up of a whole number and a fraction.

2. Two or more fractions that name the same amount are

   _____.

3. A _____ is a number that names part of a group.

Write the fraction or mixed number for each picture.

4.

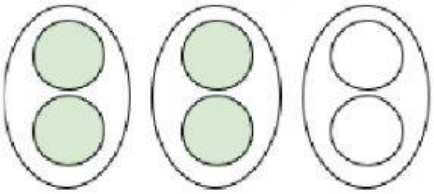

500
100

5. 2

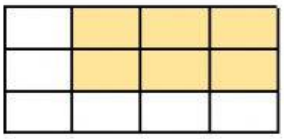

500
100

LIVEWORKSHEETS

6.

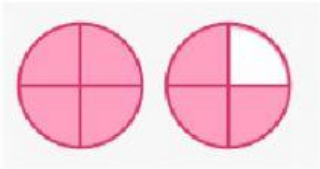

500
100

Write each fraction in its simplest form.

7.

$\frac{2}{12}$

8.

$\frac{15}{20}$

9.

$\frac{6}{9}$

Compare. Write <, > or =.

10.

$\frac{2}{3}$ $\frac{2}{12}$

11.

$\frac{1}{3}$ $\frac{1}{4}$

12.

$\frac{9}{12}$ $\frac{9}{12}$

LIVEWORKSHEETS