ATIVIDADE INTERATIVA DE MATEMÁTICA

FIGURAS GEOMÉTRICAS PLANAS

1) ADIVINHAÇÃO DAS FIGURAS GEOMÉTRICAS. ESCREVA AS RESPOSTAS:

QUEM SOU EU?

TENHO QUATRO LADOS IGUAIS.
SOU SEU AMIGO.
PODE-SE FAZER VÁRIOS DESENHOS COMIGO.
SOU O _____.



QUADRADO

SOU LEGAL PARA BRINCAR.
TENHO TRÊS LADOS.
VOCÊ QUER ME DESENHAR?
SOU O _____.

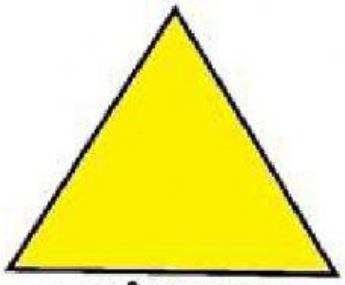

TRIÂNGULO

SOU REDONDO COMO BOLA.
NÃO ME CONFUNDA COM MOLA
SOU O _____.

SOU ASSIM:
DOIS LADOS PEQUENOS,
E DOIS MAIORES.
FAÇA UM X EM MIM:



RETÂNGULO



CÍRCULO

LIVEWORKSHEETS

2) LIGUE OS OBJETOS ÀS SUAS FORMAS CORRESPONDENTES:

1. 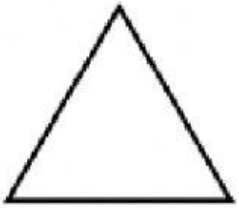

2. 

3. 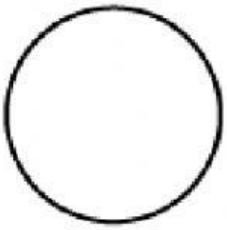

4. 

a. 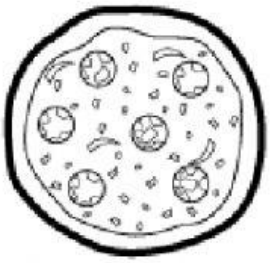

b.

c. 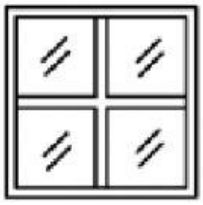

d.

LIVEWORKSHEETS

3) VEJA OS DESENHOS E AS FORMAS DELES! MARQUE AQUELES CUJAS FORMAS SÃO SEMLHANTES ÀS DO PRIMEIRO QUADRO:

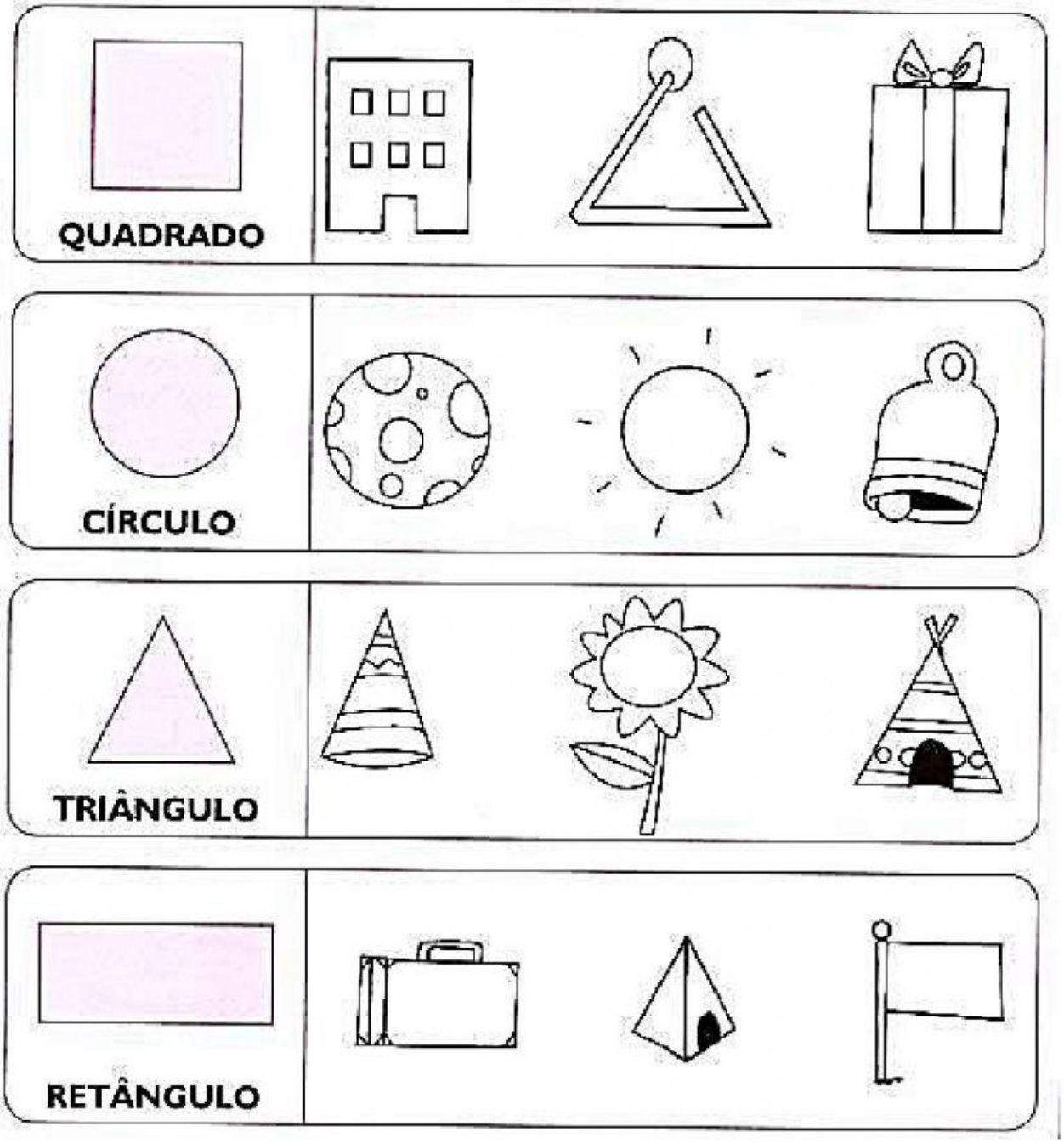

DESENHE E ESCREVA O NOME DAS QUATRO FIGURAS GEOMÉTRICAS DESTA ATIVIDADE EM SEU CADERNO.

LIVEWORKSHEETS