Doubles to 10

Butterfly Doubles

Write the number sentence for each butterfly double.



1 + 1 = _____



2 + 2 = _____



3 + 3 = _____



4 + 4 = _____



5 + 5 = _____

LIVEWORKSHEETS