Name:_____ Class:_____ Date:_____

Lesson 9-4 Practice

Subjective Short Answer

Circle the shapes described.

1. shapes with 3 sides

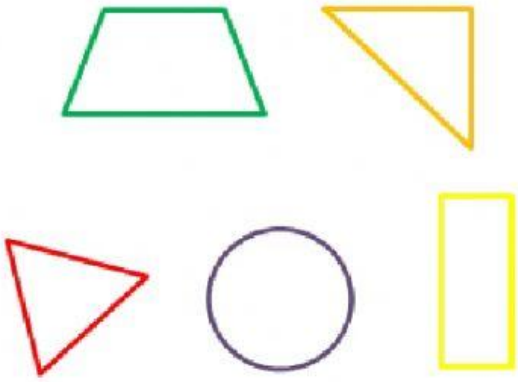

2. shapes that are curved

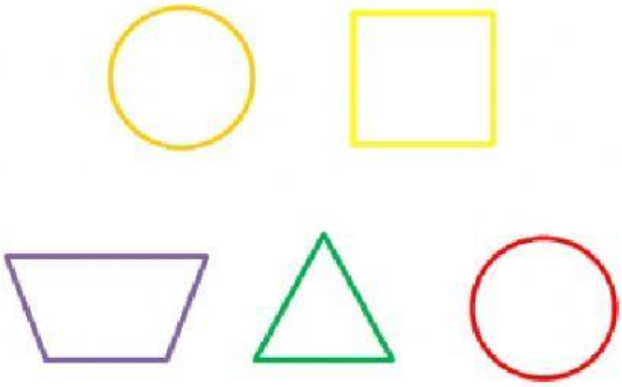

LIVEWORKSHEETS

Name:_____ Class:_____ Date:_____

Lesson 9-4 Practice

3. shapes with 4 vertices

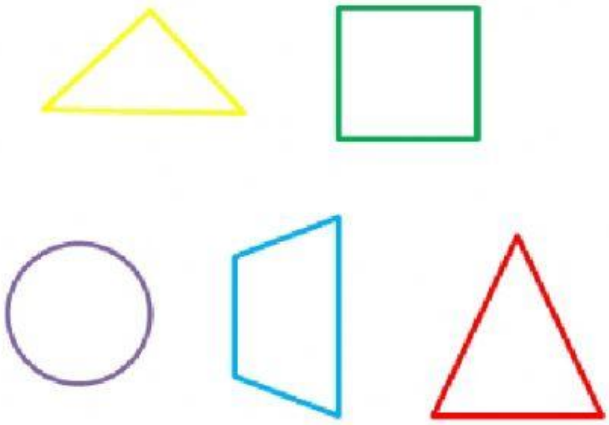

4. shapes with 3 sides and 3 vertices

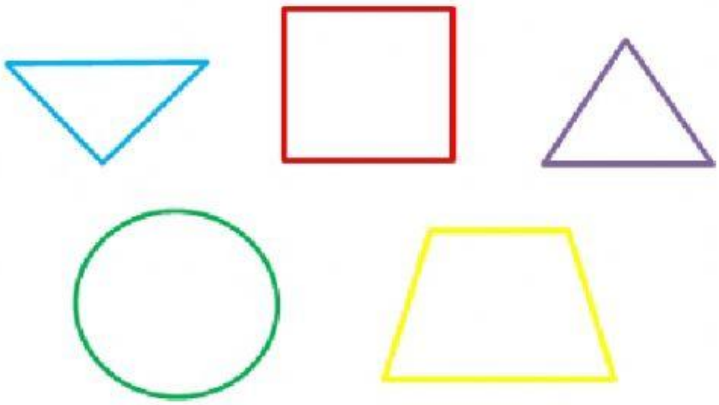

5. shapes with 0 sides

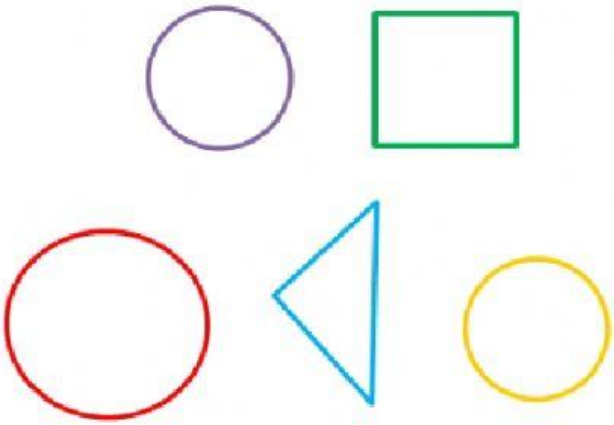

LIVEWORKSHEETS

Name:_____ Class:_____ Date:_____

Lesson 9-4 Practice

6. shapes with 4 sides the same length

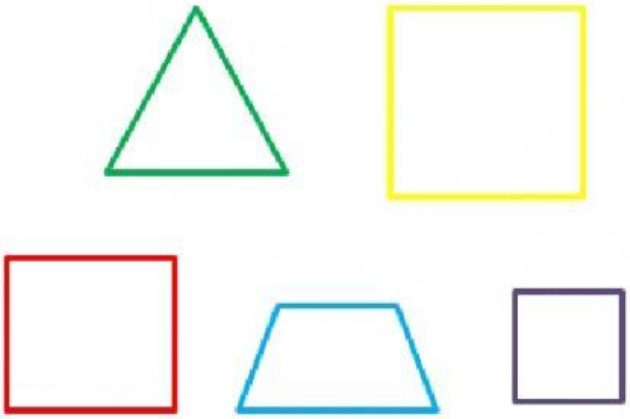

7. shapes with more than 3 vertices

8. shapes with straight sides

LIVEWORKSHEETS

Name:_____ Class:_____ Date:_____

Lesson 9-4 Practice

9. shapes with less than 4 sides

Essay

10. Maggie sees these signs on the way to soccer practice. How many of the signs have 4 vertices?

_____ signs

LIVEWORKSHEETS