ESCOLA:

NOME:

ATIVIDADE DE MATEMÁTICA

1º)Indique a que sólido geométrico correspondem as planificações:

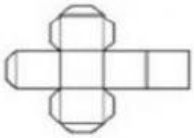

_____

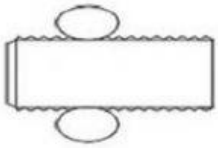

_____

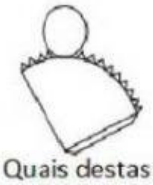

_____

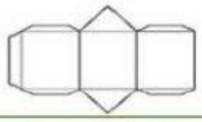

_____

2º) Quais destas são pirâmides? Marque as letras onde estão as pirâmides.

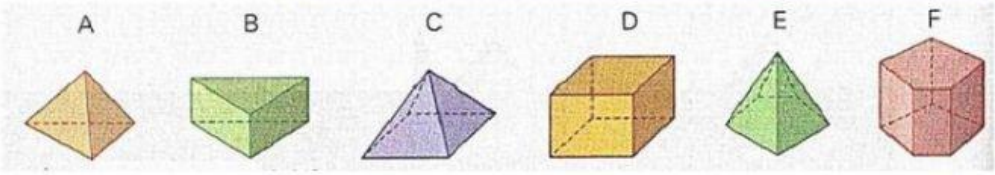

3º)Observe a figura.

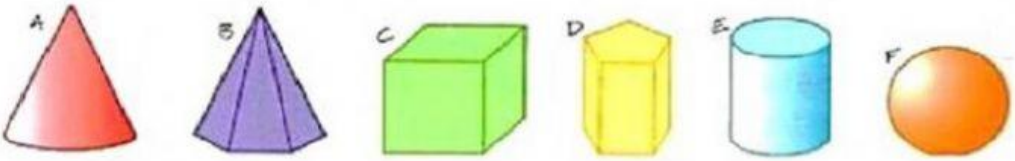

Identifique os sólidos representados através da letra correspondente.

a)esfera_____ b)cubo_____ c)pirâmide_____

d) cilindro_____ e)cone_____ f)prisma_____

4º)Marque com um (X) os sólidos geométricos que compõe cada figura.

( )pirâmide e prisma

( )cone e cilindro

( )paralelepípedo e esfera

( )cone e esfera

( )cone e cilindro

( )pirâmide e cubo

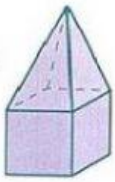

( )esfera e cone

( )cone e cilindro

( )pirâmide e cubo

( )cone e cilindro

( )pirâmide e cubo

( ) Prisma e paralelepípedo

LIVEWORKSHEETS