3D Shape Properties

Write a description for each shape. Think carefully about their properties.

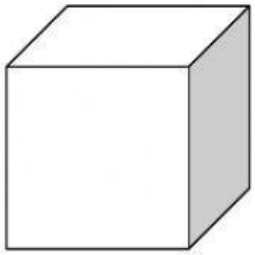	This 3D shape is a _____. It has Faces: _____ Vertices: _____
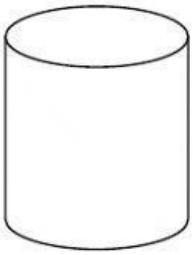	This 3D shape is a _____. It has Faces: _____ Vertices: _____
	This 3D shape is a _____. It has Faces: _____ Vertices: _____
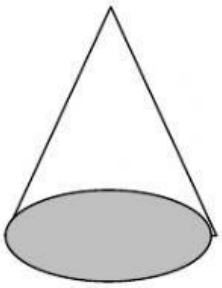	This 3D shape is a _____. It has Faces: _____ Vertices: _____
	This 3D shape is a _____. It has Faces: _____ Vertices: _____

LIVEWORKSHEETS