APPLICATION
[40 Marks]

The picture shows Bob's toy box.



1. Arrange the letters on the toy box into groups so that all letters with the same shape are grouped together.

Answer: _____ [3]

2. Jane is ten years old today. Her parents invited 29 of her friends to her birthday celebration. Show the grouping for the number '29' using tally marks.

Answer: _____ [1]

[GO ON]

LIVEWORKSHEETS

3. Green Castle Primary School had 655 parents and 203 students attend the school fair. What was the total number of persons who attended the school fair?

Answer: _____ [1]

Use the picture to answer question 4.

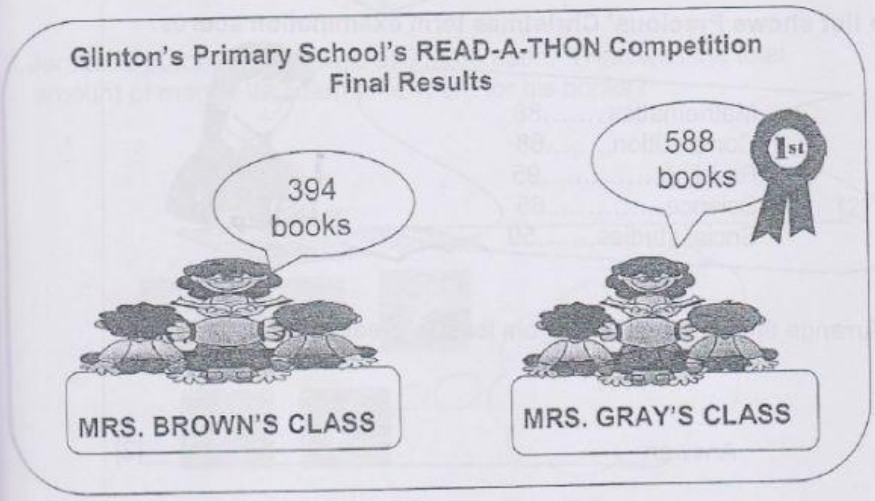

4. What was the total number of books that the two classes read altogether?

Answer: _____ [2]

[GO ON]

LIVEWORKSHEETS

5. Mrs. Brown planted 426 sun flower plants in her garden. 123 of the plants withered and died. How many full grown sun flower plants were left in the garden?

Answer: _____[1]

The list shows Precious' Christmas term examination scores.



6.(a) Arrange the scores in order from least to greatest.

Answer: _____[2]

6.(b) Find the difference between the largest and the smallest scores in the group.

Answer: _____[2]

[GO ON]

LIVEWORKSHEETS

7. Jim has three U-haul trucks at his recycling plant. Each truck holds 532 cans. What is the total number of cans that the 3 trucks can hold altogether?

Answer: _____[1]

8. Jermaine purchased 8 books at $14.35 each. What was the total amount of money that Jermaine spent for his books?

Answer: _____[2]

9. Fred had 675 packages of gummy bears candies. He shared the candies equally between five boxes. How many packages of candies did Fred place in each box?

Answer: _____[2]

[GO ON]

LIVEWORKSHEETS

10.Keisha collected 321 leaves. She shared the leaves into 7 groups.

(a) How many leaves did Keisha place in each group?

Answer: _____[2]

(b) What was the total number of leaves Keisha used to make up her seven groups?

Answer: _____[2]

(c) How many leaves did Keisha have left over after making up the seven groups?

Answer: _____[2]

[GO ON]

LIVEWORKSHEETS

11. Susan and Lydia picked fruits from the trees in their garden. Susan picked 5 mangoes and 2 apples and Lydia picked 3 mangoes and 4 apples.

Write an equation to show the total number of fruits that each girl picked from the garden.

Answer: _____[2]

Use the shapes to answer question 12. (a) &12. (b).

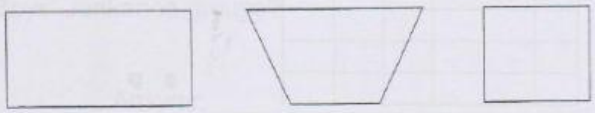

12.(a) Benjamin has a plane shape that has two long sides and two short sides that are equal. Place an 'X' on the picture that shows Benjamin's shape.

Answer: [1]

12. (b) How many edges does Benjamin's shape have?

Answer: _____[1]

[GO ON]

LIVEWORKSHEETS

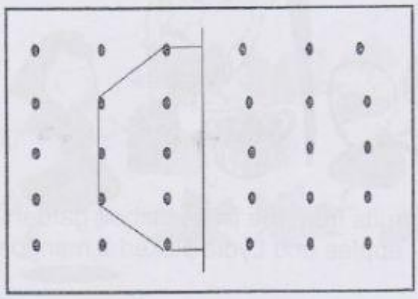

13. Use the line of symmetry shown to draw the matching part of the shape to complete it.

Answer: _____[2]



14. (a) Find the perimeter of the shape above.

Answer: _____[2]

14. (b) Find the area of the shape above.

Answer: _____[2]

[GO ON]

LIVEWORKSHEETS

Use the graph to answer questions 15 (a), (b) (c) & (d)

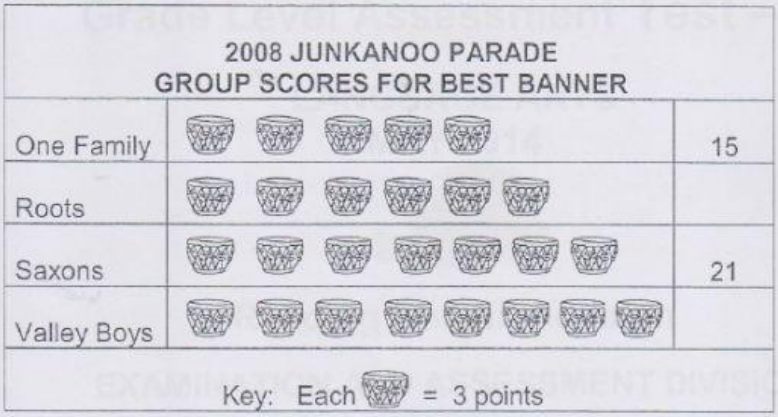

15.(a) Complete the graph to show the scores for each group.

Answer: [2]

15.(b) What is the total combined score for the 'Roots' and the 'Valley Boys' Junkanoo groups?

Answer:_____ [2]

15.(c) What is the difference between the scores of the 'Saxons' and the 'One Family' Junkanoo groups?

Answer:_____ [2]

15.(d) What was the total number of points awarded for the banner during the 2008 Junkanoo parade?

Answer: _____ [2]

[THE END]

LIVEWORKSHEETS