Al Ezzah School

Math Pop Quiz

Grade 3

Term 3

Learning Outcomes: Line Segments and Shapes

Question 1:

Is this a point, line or ray ?

Question 2:

What is this ?

LIVEWORKSHEETS

Question 3:

What is this ?

Question 4:

What is this ?

Question 5:

Which picture shows a right angle ?

a) 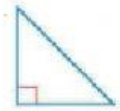

b) 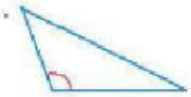

c)

LIVEWORKSHEETS

Question 6:

Which picture shows an angle that is less than a right angle ?

a)

b) 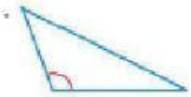

c) 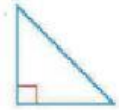

LIVEWORKSHEETS

Question 7:

Which picture shows an angle that is more than a right angle ?

a)

b) 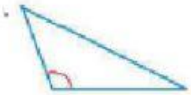

c) 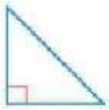

Question 8:

What shape is this ?

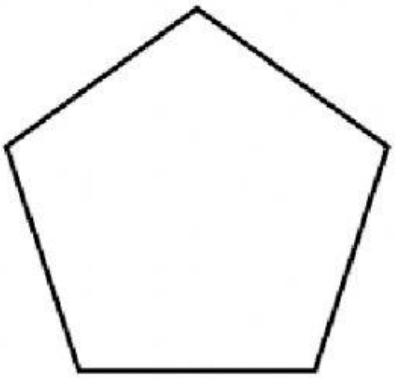

LIVEWORKSHEETS

Question 9:

How many sides does a pentagon have ?

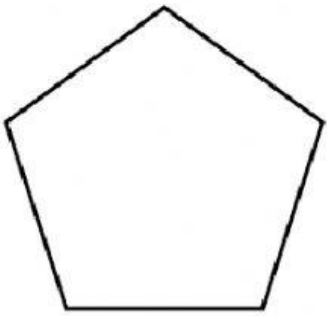

Question 10:

How many angles does a pentagon have ?

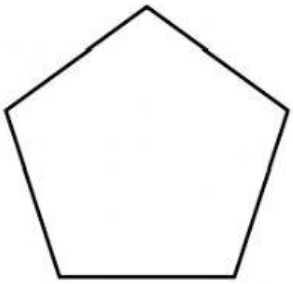

LIVEWORKSHEETS