Unit 9- Adding groups with Number line

Write number sentences for the given numberline

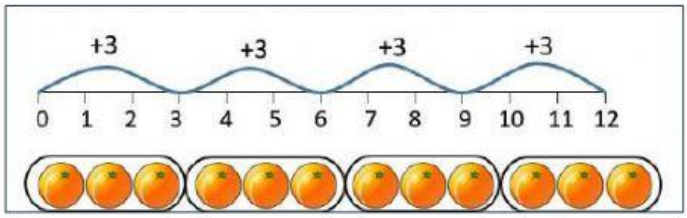

___+___+___+___=12

___ x ___ = 12

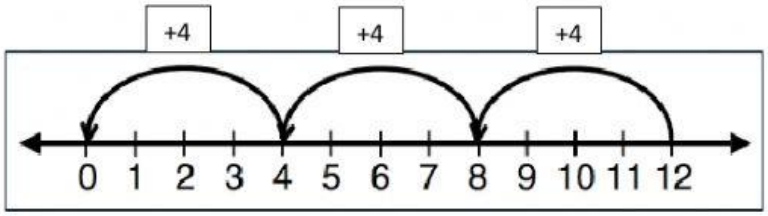

____+___+___=12

___ x ___ = 12

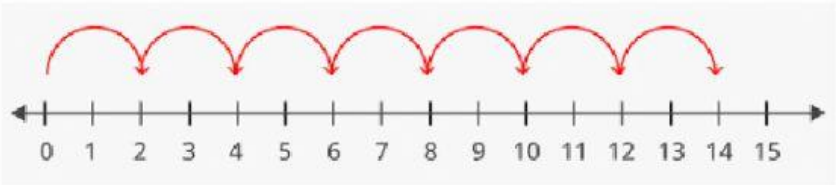

2 + 2 +___+___+___+___+___=___

___ x ___ = 14

MS POONAM

LIVEWORKSHEETS